Coins & Their Values

NAME: DATE: SCORE:

Coin Reference

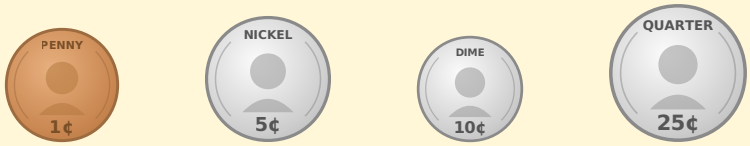

Part A: Fill in the blank to make the amounts equal.

1. 1 dime = _____ pennies

2. 1 quarter = _____ nickels

3. 2 quarters = _____ ¢

4. 3 dimes + 2 nickels = _____ ¢

5. 4 quarters = $ _____

6. _____ nickels = 1 dollar ($1.00)

7. 1 quarter + 1 dime + 1 nickel = _____ ¢

8. 3 quarters = _____ ¢

Part B: Circle the group of coins that equals the target amount.

= 30¢

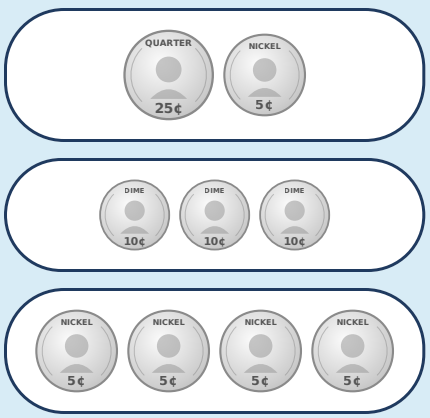

= 20¢



= 75¢

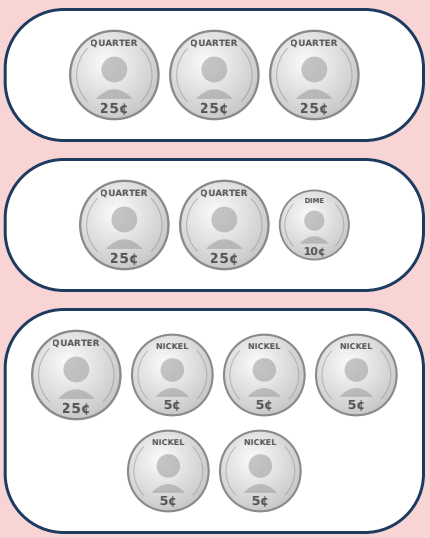

Place Value Power!

NAME: DATE: SCORE:

HUNDREDS each = 100 **TENS** each = 10 **ONES** each = 1

Place → H | T | O

Part A: Read the place-value chart. Write the standard number.

H	T	O
5	2	8

Standard form: _____

H	T	O
4	0	9

Standard form: _____

H	T	O
2	7	1

Standard form: _____

H	T	O
0	9	4

Standard form: _____

Part B: Write the expanded form. (e.g. 342 = 300 + 40 + 2)

638 = _____ + _____ + _____

504 = _____ + _____ + _____

820 = _____ + _____ + _____

76 = _____ + _____

392 = _____ + _____ + _____

460 = _____ + _____

Part C: Write <, >, or = between each pair.

185 ____ 158

600 ____ 599

307 ____ 370

425 ____ 425

Count It Up!

NAME: DATE: SCORE:

Add up all the bills and coins shown. Write the total amount.

Problem 1:



Total = $ _____

Problem 2:



Total = $ _____

Problem 3:



Total = $ _____

Problem 4:



Total = $ _____

Problem 5:



Total = $ _____

Problem 6:

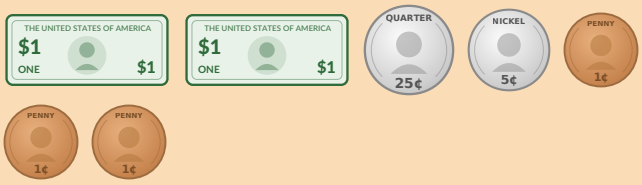

Total = $ _____

Word Problem:
Ava has 2 one-dollar bills, 2 quarters, 3 dimes, and 1 nickel. She wants to buy a sandwich for $2.95. Does she have enough money?

How much does Ava have? $ _____ Circle: YES / NO

Making Change from $1

NAME: DATE: SCORE:

Strategy: Change = $1.00 – Cost of Item
Example: Cost = 38¢ → $1.00 – $0.38 = $0.62 change
Count-Up tip: 38¢ → 40¢ (+2¢) → 50¢ (+10¢) → $1.00 (+50¢) = 62¢ total change

Part A: Subtract to find the change from $1.00.

Write your answer on the line. The cost has been converted to dollars for you.

Eraser
Cost: 32¢

$1.00
– $0.32
_____

_____

Sticker
Cost: 67¢

$1.00
– $0.67
_____

_____

Apple
Cost: 95¢

$1.00
– $0.95
_____

_____

Marker
Cost: 41¢

$1.00
– $0.41
_____

_____

Gum
Cost: 26¢

$1.00
– $0.26
_____

_____

Folder
Cost: 89¢

$1.00
– $0.89
_____

_____

Part B: List the fewest coins to make each amount of change.

Change: 43¢
_____ Q
_____ D
_____ N
_____ P

Q=25¢ D=10¢ N=5¢ P=1¢

Change: 67¢
_____ Q
_____ D
_____ N
_____ P

Q=25¢ D=10¢ N=5¢ P=1¢

Change: 81¢
_____ Q
_____ D
_____ N
_____ P

Q=25¢ D=10¢ N=5¢ P=1¢

Change: 28¢
_____ Q
_____ D
_____ N
_____ P

Q=25¢ D=10¢ N=5¢ P=1¢

Money Word Problems

NAME: DATE: SCORE:

Read each problem carefully. Write your answer in the box.

1

A muffin costs 62¢ and a juice box costs 89¢. Maya buys both. How much does she spend in total?

2

Dev has $3.00. He spends $2.16 on a notebook. How much money does he have left?

3

A library has 528 books. On Monday, 145 more arrive. Write the total in standard AND expanded form.

4

Nia has 2 quarters, 3 dimes, and 6 pennies. She finds 1 more dime in her pocket. How much does she have now?

5

What is the value of the digit 7 in 752?

6

Arrange from LEAST to GREATEST:
$0.85, $1.50, $0.40, $2.25, $1.05