Counting Money

Sheet 2

Name: _____ Date: _____

Count the bills and coins in each box. Circle the correct total amount.

1)



a) $25.15 b) $25.65
c) $20.65 d) $30.65

2)

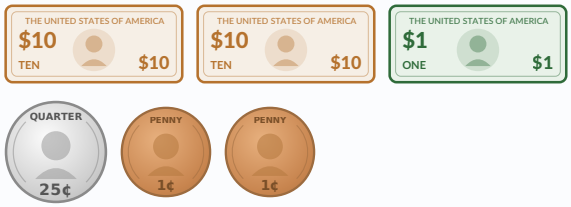

a) $21.52 b) $11.27
c) $21.27 d) $20.27

3)

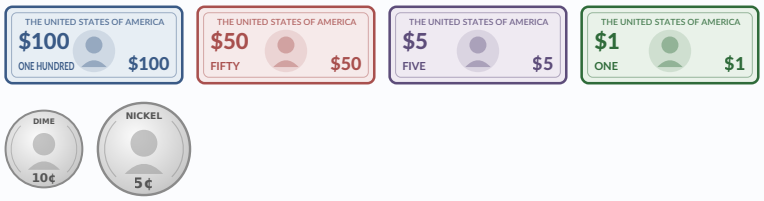

a) $156.15 b) $156.65
c) $106.15 d) $151.15

4)

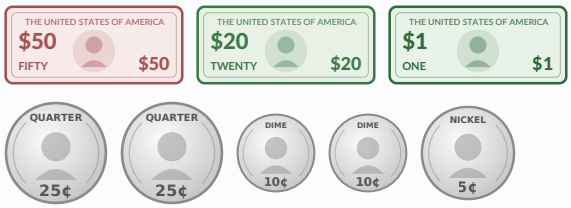

a) $71.25 b) $70.75
c) $76.75 d) $71.75

5)

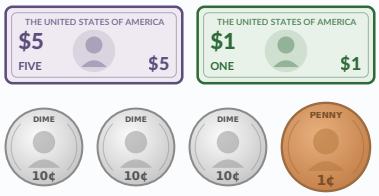

a) $6.13 b) $6.31
c) $5.31 d) $6.81

6)

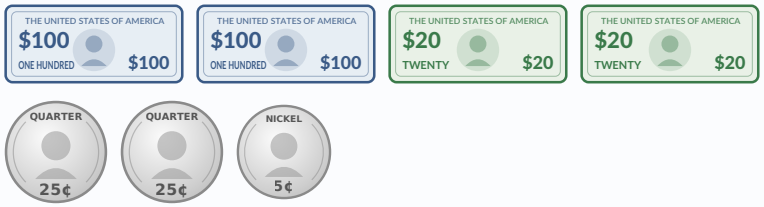

a) $240.05 b) $245.55
c) $240.55 d) $200.55