Counting Money

Easier

Name: _____ Date: _____

Count the bills and coins in each box. Circle the correct total amount.

1)

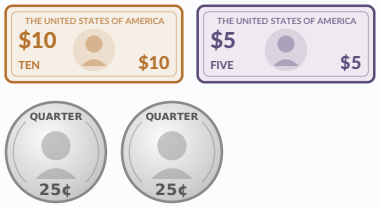

a) $15.50 b) $15.05 c) $10.50 d) $20.50

2)



a) $21.55 b) $11.15 c) $21.15 d) $20.15

3)



a) $7.72 b) $6.27 c) $7.07 d) $7.27

4)



a) $45.75 b) $45.25 c) $40.25 d) $50.25

5)

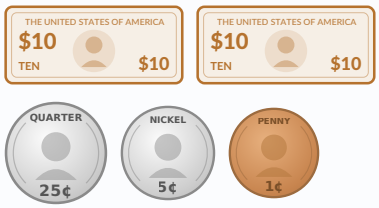

a) $20.13 b) $25.31 c) $20.31 d) $10.31

6)



a) $11.03 b) $11.30 c) $10.30 d) $16.30