Counting Money

Liczenie pieniędzy

Easier

Name: · *Imię i nazwisko:*

Date: · *Data:*

Count the bills and coins in each box. Circle the correct total amount.

Policz banknoty i monety w każdym polu. Zakreśl właściwą kwotę.

1)

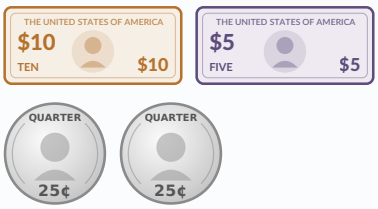

a) $15.50 b) $15.05

c) $10.50 d) $20.50

2)

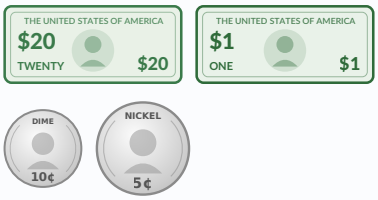

a) $21.55 b) $11.15

c) $21.15 d) $20.15

3)



a) $7.72 b) $6.27

c) $7.07 d) $7.27

4)

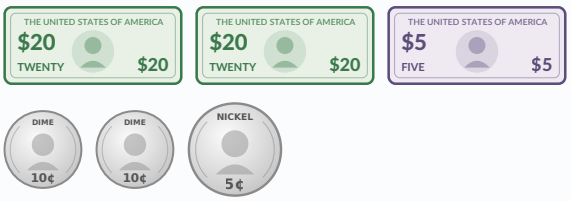

a) $45.75 b) $45.25

c) $40.25 d) $50.25

5)

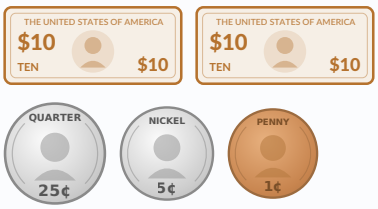

a) $20.13 b) $25.31

c) $20.31 d) $10.31

6)

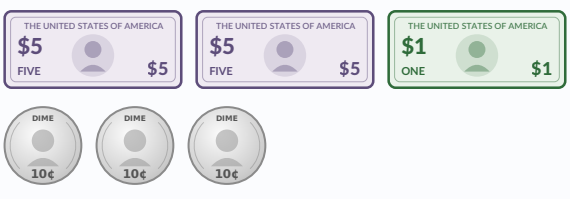

a) $11.03 b) $11.30

c) $10.30 d) $16.30