Count & Match — Money

Easier

Name: _____ Date: _____

Count the bills and coins in each box. Draw a line to match each set with its total value.

1)

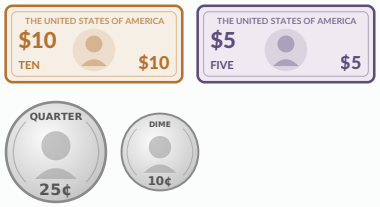

$40.16

2)

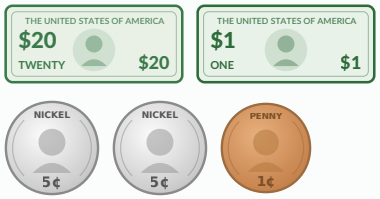

$15.35

3)

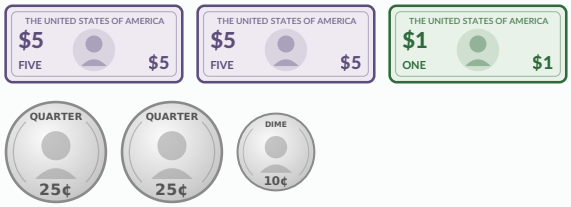

$6.25

4)



$21.11

5)



$11.60

6)

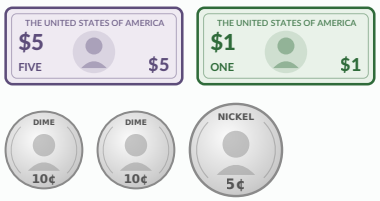

$12.30