Count & Match — Money

Name: _____ Date: _____

Count the coins in each box. Draw a line to match each set with its total value.

1) 

2) 

3) 

4) 

5) 

●	● 31¢
●	● 50¢
●	● 35¢
●	● 25¢
●	● 12¢

Count & Match — Money

Name: _____ Date: _____

Count the coins in each box. Draw a line to match each set with its total value.

1) 

2) 

3) 

4) 

5) 

●	● 37¢
●	● 77¢
●	● 75¢
●	● 66¢
●	● 55¢

Count & Match — Money

Name: _____ Date: _____

Count the bills and coins in each box. Draw a line to match each set with its total value.

1) 

2) 

3) 

4) 

5) 

- $2.50
- $10.20
- $3.25
- $6.35
- $5.16

Count & Match — Money

Name: _____ Date: _____

Count the bills and coins in each box. Draw a line to match each set with its total value.

1) 

2) 

3) 

4) 

5) 

- $16.15
- $21.25
- $12.21
- $11.50
- $15.55

Count & Match — Money

Name: _____ Date: _____

Count the bills and coins in each box. Draw a line to match each set with its total value.

1) 

2) 

3) 

4) 

5) 

- $25.32
- $26.61
- $40.42
- $26.50
- $32.26

Count & Match — Money

Name: _____ Date: _____

Count the bills and coins in each box. Draw a line to match each set with its total value.

1) 

2) 

3) 

4) 

5) 

- $30.40
- $61.00
- $56.51
- $56.66
- $40.82

Count & Match — Money

Name: _____ Date: _____

Count the bills and coins in each box. Draw a line to match each set with its total value.

1) 

2) 

3) 

4) 

5) 

$27.06

$41.75

$25.41

$75.57

$75.42